CAMBRIDGE
UNIVERSITY PRESS & ASSESSMENT

A Level

Mathematics

Session:	2010 June
Type:	Question paper
Code:	3890-7890; 3892-7892
Units:	4725, 4726, 4727

© UCLES

OCR
RECOGNISING ACHIEVEMENT

ADVANCED SUBSIDIARY GCE

MATHEMATICS 4725

Further Pure Mathematics 1

Candidates answer on the Answer Booklet

OCR Supplied Materials:
- 8 page Answer Booklet
- List of Formulae (MF1)

Other Materials Required:
- Scientific or graphical calculator

Friday 11 June 2010
Morning

Duration: 1 hour 30 minutes

INSTRUCTIONS TO CANDIDATES

- Write your name clearly in capital letters, your Centre Number and Candidate Number in the spaces provided on the Answer Booklet.
- Use black ink. Pencil may be used for graphs and diagrams only.
- Read each question carefully and make sure that you know what you have to do before starting your answer.
- Answer **all** the questions.
- Do **not** write in the bar codes.
- Give non-exact numerical answers correct to 3 significant figures unless a different degree of accuracy is specified in the question or is clearly appropriate.
- You are permitted to use a graphical calculator in this paper.

INFORMATION FOR CANDIDATES

- The number of marks is given in brackets **[ ]** at the end of each question or part question.
- **You are reminded of the need for clear presentation in your answers.**
- The total number of marks for this paper is **72.**
- This document consists of **4** pages. Any blank pages are indicated.

© OCR 2010 [T/102/2698]
OCR is an exempt Charity

1 Prove by induction that, for $n \geqslant 1$, $\sum_{r=1}^{n} r(r+1) = \frac{1}{3}n(n+1)(n+2)$. **[5]**

2 The matrices **A**, **B** and **C** are given by $\mathbf{A} = \begin{pmatrix} 1 & -4 \end{pmatrix}$, $\mathbf{B} = \begin{pmatrix} 5 \\ 3 \end{pmatrix}$ and $\mathbf{C} = \begin{pmatrix} 3 & 0 \\ -2 & 2 \end{pmatrix}$. Find

(i) **AB**, **[2]**

(ii) **BA** $-$ 4**C**. **[4]**

3 Find $\sum_{r=1}^{n}(2r-1)^2$, expressing your answer in a fully factorised form. **[6]**

4 The complex numbers a and b are given by $a = 7 + 6\mathrm{i}$ and $b = 1 - 3\mathrm{i}$. Showing clearly how you obtain your answers, find

(i) $|a - 2b|$ and $\arg(a - 2b)$, **[4]**

(ii) $\dfrac{b}{a}$, giving your answer in the form $x + \mathrm{i}y$. **[3]**

5 **(a)** Write down the matrix that represents a reflection in the line $y = x$. **[2]**

(b) Describe fully the geometrical transformation represented by each of the following matrices:

(i) $\begin{pmatrix} 5 & 0 \\ 0 & 1 \end{pmatrix}$, **[2]**

(ii) $\begin{pmatrix} \frac{1}{2} & \frac{1}{2}\sqrt{3} \\ -\frac{1}{2}\sqrt{3} & \frac{1}{2} \end{pmatrix}$. **[2]**

6 **(i)** Sketch on a single Argand diagram the loci given by

(a) $|z - 3 + 4\mathrm{i}| = 5$, **[2]**

(b) $|z| = |z - 6|$. **[2]**

(ii) Indicate, by shading, the region of the Argand diagram for which

$$|z - 3 + 4\mathrm{i}| \leqslant 5 \quad \text{and} \quad |z| \geqslant |z - 6|.$$ **[2]**

7 The quadratic equation $x^2 + 2kx + k = 0$, where k is a non-zero constant, has roots α and β. Find a quadratic equation with roots $\dfrac{\alpha + \beta}{\alpha}$ and $\dfrac{\alpha + \beta}{\beta}$. **[7]**

© OCR 2010

8 **(i)** Show that $\dfrac{1}{\sqrt{r+2}+\sqrt{r}} \equiv \dfrac{\sqrt{r+2}-\sqrt{r}}{2}$. **[2]**

(ii) Hence find an expression, in terms of n, for

$$\sum_{r=1}^{n} \frac{1}{\sqrt{r+2}+\sqrt{r}}.$$ **[6]**

(iii) State, giving a brief reason, whether the series $\displaystyle\sum_{r=1}^{\infty} \frac{1}{\sqrt{r+2}+\sqrt{r}}$ converges. **[1]**

9 The matrix $\mathbf{A}$ is given by $\mathbf{A} = \begin{pmatrix} a & a & -1 \\ 0 & a & 2 \\ 1 & 2 & 1 \end{pmatrix}$.

(i) Find, in terms of a, the determinant of $\mathbf{A}$. **[3]**

(ii) Three simultaneous equations are shown below.

$$\begin{aligned} ax + ay - z &= -1 \\ ay + 2z &= 2a \\ x + 2y + z &= 1 \end{aligned}$$

For each of the following values of a, determine whether the equations are consistent or inconsistent. If the equations are consistent, determine whether or not there is a unique solution.

(a) $a = 0$

(b) $a = 1$

(c) $a = 2$

[6]

10 The complex number z, where $0 < \arg z < \frac{1}{2}\pi$, is such that $z^2 = 3 + 4\mathrm{i}$.

(i) Use an algebraic method to find z. **[5]**

(ii) Show that $z^3 = 2 + 11\mathrm{i}$. **[1]**

The complex number w is the root of the equation

$$w^6 - 4w^3 + 125 = 0$$

for which $-\frac{1}{2}\pi < \arg w < 0$.

(iii) Find w. **[5]**

© OCR 2010

Archives & Heritage

OCR
RECOGNISING ACHIEVEMENT

Copyright Information

OCR is committed to seeking permission to reproduce all third-party content that it uses in its assessment materials. OCR has attempted to identify and contact all copyright holders whose work is used in this paper. To avoid the issue of disclosure of answer-related information to candidates, all copyright acknowledgements are reproduced in the OCR Copyright Acknowledgements Booklet. This is produced for each series of examinations, is given to all schools that receive assessment material and is freely available to download from our public website (www.ocr.org.uk) after the live examination series.

If OCR has unwittingly failed to correctly acknowledge or clear any third-party content in this assessment material, OCR will be happy to correct its mistake at the earliest possible opportunity.

For queries or further information please contact the Copyright Team, First Floor, 9 Hills Road, Cambridge CB2 1GE.

OCR is part of the Cambridge Assessment Group; Cambridge Assessment is the brand name of University of Cambridge Local Examinations Syndicate (UCLES), which is itself a department of the University of Cambridge.

© OCR 2010

OCR
RECOGNISING ACHIEVEMENT

ADVANCED GCE

MATHEMATICS

4726

Further Pure Mathematics 2

Candidates answer on the Answer Booklet

OCR Supplied Materials:
- 8 page Answer Booklet
- List of Formulae (MF1)

Other Materials Required:
- Scientific or graphical calculator

Thursday 27 May 2010
Morning

Duration: 1 hour 30 minutes

* 4 7 2 6 *

INSTRUCTIONS TO CANDIDATES

- Write your name clearly in capital letters, your Centre Number and Candidate Number in the spaces provided on the Answer Booklet.
- Use black ink. Pencil may be used for graphs and diagrams only.
- Read each question carefully and make sure that you know what you have to do before starting your answer.
- Answer **all** the questions.
- Do **not** write in the bar codes.
- Give non-exact numerical answers correct to 3 significant figures unless a different degree of accuracy is specified in the question or is clearly appropriate.
- You are permitted to use a graphical calculator in this paper.

INFORMATION FOR CANDIDATES

- The number of marks is given in brackets **[ ]** at the end of each question or part question.
- **You are reminded of the need for clear presentation in your answers.**
- The total number of marks for this paper is **72.**
- This document consists of **4** pages. Any blank pages are indicated.

© OCR 2010 [A/102/2699]
OCR is an exempt Charity

1 It is given that $f(x) = \tan^{-1} 2x$ and $g(x) = p \tan^{-1} x$, where p is a constant. Find the value of p for which $f'(\frac{1}{2}) = g'(\frac{1}{2})$. **[4]**

2 Given that the first three terms of the Maclaurin series for $(1 + \sin x)e^{2x}$ are identical to the first three terms of the binomial series for $(1 + ax)^n$, find the values of the constants a and n. (You may use appropriate results given in the List of Formulae (MF1).) **[6]**

3 Use the substitution $t = \tan \frac{1}{2}x$ to show that

$$\int_0^{\frac{1}{3}\pi} \frac{1}{1 - \sin x}\, dx = 1 + \sqrt{3}.$$ **[6]**

4

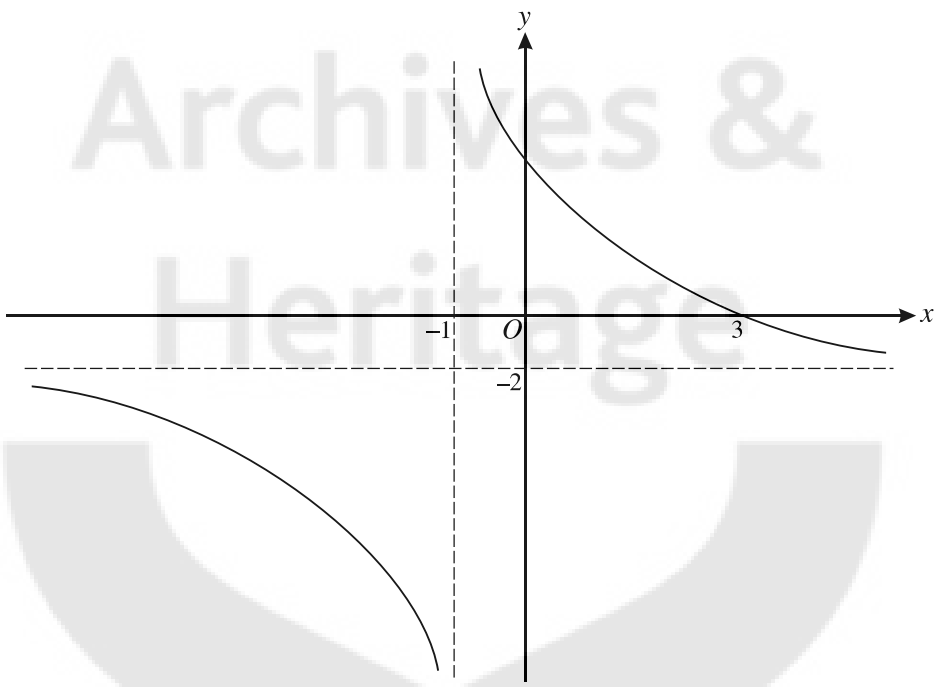

The diagram shows the curve with equation

$$y = \frac{ax + b}{x + c},$$

where a, b and c are constants.

(i) Given that the asymptotes of the curve are $x = -1$ and $y = -2$ and that the curve passes through $(3, 0)$, find the values of a, b and c. **[3]**

(ii) Sketch the curve with equation

$$y^2 = \frac{ax + b}{x + c},$$

for the values of a, b and c found in part **(i)**. State the coordinates of any points where the curve crosses the axes, and give the equations of any asymptotes. **[4]**

© OCR 2010

5 It is given that, for $n \geqslant 0$,

$$I_n = \int_0^{\frac{1}{2}} (1-2x)^n e^x \, dx.$$

(i) Prove that, for $n \geqslant 1$,

$$I_n = 2nI_{n-1} - 1.$$ **[4]**

(ii) Find the exact value of I_3. **[4]**

6 **(i)** Show that $\frac{d}{dx}(\sinh^{-1} x) = \frac{1}{\sqrt{x^2+1}}$. **[2]**

(ii) Given that $y = \cosh(a \sinh^{-1} x)$, where a is a constant, show that

$$(x^2+1)\frac{d^2y}{dx^2} + x\frac{dy}{dx} - a^2 y = 0.$$ **[5]**

7

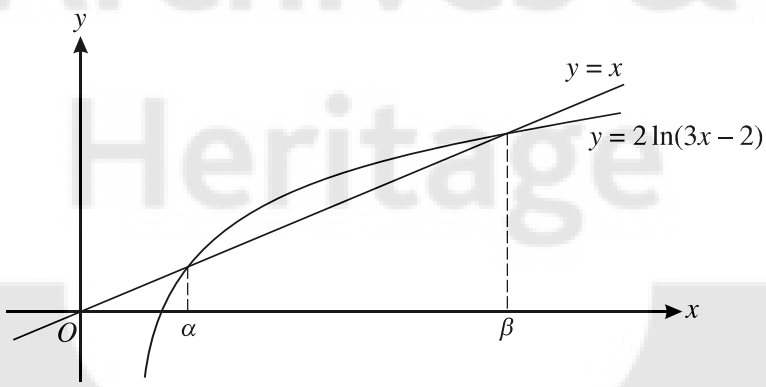

The line $y = x$ and the curve $y = 2\ln(3x-2)$ meet where $x = \alpha$ and $x = \beta$, as shown in the diagram.

(i) Use the iteration $x_{n+1} = 2\ln(3x_n - 2)$, with initial value $x_1 = 5.25$, to find the value of β correct to 2 decimal places. Show all your working. **[2]**

(ii) With the help of a 'staircase' diagram, explain why this iteration will not converge to α, whatever value of x_1 (other than α) is used. **[3]**

(iii) Show that the equation $x = 2\ln(3x-2)$ can be rewritten as $x = \frac{1}{3}\left(e^{\frac{1}{2}x} + 2\right)$. Use the Newton-Raphson method, with $f(x) = \frac{1}{3}\left(e^{\frac{1}{2}x} + 2\right) - x$ and $x_1 = 1.2$, to find α correct to 2 decimal places. Show all your working. **[4]**

(iv) Given that $x_1 = \ln 36$, explain why the Newton-Raphson method would not converge to a root of $f(x) = 0$. **[2]**

[Questions 8 and 9 are printed overleaf.]

8 **(i)** Using the definition of $\cosh x$ in terms of e^x and e^{-x}, show that

$$4\cosh^3 x - 3\cosh x \equiv \cosh 3x. \qquad \textbf{[4]}$$

(ii) Use the substitution $u = \cosh x$ to find, in terms of $5^{\frac{1}{3}}$, the real root of the equation

$$20u^3 - 15u - 13 = 0. \qquad \textbf{[6]}$$

9



The diagram shows the curve with equation $y = \sqrt{2x+1}$ between the points $A\left(-\frac{1}{2}, 0\right)$ and $B(4, 3)$.

(i) Find the area of the region bounded by the curve, the x-axis and the line $x = 4$. Hence find the area of the region bounded by the curve and the lines OA and OB, where O is the origin. **[4]**

(ii) Show that the curve between B and A can be expressed in polar coordinates as

$$r = \frac{1}{1 - \cos\theta}, \quad \text{where } \tan^{-1}\left(\tfrac{3}{4}\right) \leqslant \theta \leqslant \pi. \qquad \textbf{[5]}$$

(iii) Deduce from parts **(i)** and **(ii)** that $\displaystyle\int_{\tan^{-1}\left(\frac{3}{4}\right)}^{\pi} \operatorname{cosec}^4\left(\tfrac{1}{2}\theta\right) d\theta = 24.$ **[4]**

OCR
RECOGNISING ACHIEVEMENT

Copyright Information

OCR is committed to seeking permission to reproduce all third-party content that it uses in its assessment materials. OCR has attempted to identify and contact all copyright holders whose work is used in this paper. To avoid the issue of disclosure of answer-related information to candidates, all copyright acknowledgements are reproduced in the OCR Copyright Acknowledgements Booklet. This is produced for each series of examinations, is given to all schools that receive assessment material and is freely available to download from our public website (www.ocr.org.uk) after the live examination series.

If OCR has unwittingly failed to correctly acknowledge or clear any third-party content in this assessment material, OCR will be happy to correct its mistake at the earliest possible opportunity.

For queries or further information please contact the Copyright Team, First Floor, 9 Hills Road, Cambridge CB2 1GE.

OCR is part of the Cambridge Assessment Group; Cambridge Assessment is the brand name of University of Cambridge Local Examinations Syndicate (UCLES), which is itself a department of the University of Cambridge.

© OCR 2010

OCR
RECOGNISING ACHIEVEMENT

ADVANCED GCE

MATHEMATICS

4727

Further Pure Mathematics 3

Candidates answer on the Answer Booklet

OCR Supplied Materials:
- 8 page Answer Booklet
- List of Formulae (MF1)

Other Materials Required:
- Scientific or graphical calculator

Monday 24 May 2010
Afternoon

Duration: 1 hour 30 minutes

INSTRUCTIONS TO CANDIDATES

- Write your name clearly in capital letters, your Centre Number and Candidate Number in the spaces provided on the Answer Booklet.
- Use black ink. Pencil may be used for graphs and diagrams only.
- Read each question carefully and make sure that you know what you have to do before starting your answer.
- Answer **all** the questions.
- Do **not** write in the bar codes.
- Give non-exact numerical answers correct to 3 significant figures unless a different degree of accuracy is specified in the question or is clearly appropriate.
- You are permitted to use a graphical calculator in this paper.

INFORMATION FOR CANDIDATES

- The number of marks is given in brackets **[ ]** at the end of each question or part question.
- **You are reminded of the need for clear presentation in your answers.**
- The total number of marks for this paper is **72.**
- This document consists of **4** pages. Any blank pages are indicated.

© OCR 2010 [H/102/2700]
OCR is an exempt Charity

1 The line l_1 passes through the points (0, 0, 10) and (7, 0, 0) and the line l_2 passes through the points (4, 6, 0) and (3, 3, 1). Find the shortest distance between l_1 and l_2. **[7]**

2 A multiplicative group with identity e contains distinct elements a and r, with the properties $r^6 = e$ and $ar = r^5a$.

(i) Prove that $rar = a$. **[2]**

(ii) Prove, by induction or otherwise, that $r^n a r^n = a$ for all positive integers n. **[4]**

3 In this question, w denotes the complex number $\cos\frac{2}{5}\pi + \mathrm{i}\sin\frac{2}{5}\pi$.

(i) Express w^2, w^3 and w^* in polar form, with arguments in the interval $0 \leqslant \theta < 2\pi$. **[4]**

(ii) The points in an Argand diagram which represent the numbers

$$1, \quad 1 + w, \quad 1 + w + w^2, \quad 1 + w + w^2 + w^3, \quad 1 + w + w^2 + w^3 + w^4$$

are denoted by A, B, C, D, E respectively. Sketch the Argand diagram to show these points and join them in the order stated. (Your diagram need not be exactly to scale, but it should show the important features.) **[4]**

(iii) Write down a polynomial equation of degree 5 which is satisfied by w. **[1]**

4 **(i)** Use the substitution $y = xz$ to find the general solution of the differential equation

$$x\frac{\mathrm{d}y}{\mathrm{d}x} - y = x\cos\left(\frac{y}{x}\right),$$

giving your answer in a form without logarithms. (You may quote an appropriate result given in the List of Formulae (MF1).) **[6]**

(ii) Find the solution of the differential equation for which $y = \pi$ when $x = 4$. **[2]**

5 Convergent infinite series C and S are defined by

$$C = 1 + \tfrac{1}{2}\cos\theta + \tfrac{1}{4}\cos 2\theta + \tfrac{1}{8}\cos 3\theta + \ldots ,$$
$$S = \tfrac{1}{2}\sin\theta + \tfrac{1}{4}\sin 2\theta + \tfrac{1}{8}\sin 3\theta + \ldots .$$

(i) Show that $C + \mathrm{i}S = \dfrac{2}{2 - \mathrm{e}^{\mathrm{i}\theta}}$. **[4]**

(ii) Hence show that $C = \dfrac{4 - 2\cos\theta}{5 - 4\cos\theta}$, and find a similar expression for S. **[4]**

© OCR 2010

6 **(i)** Find the general solution of the differential equation

$$\frac{d^2y}{dx^2} + 2\frac{dy}{dx} + 17y = 17x + 36.$$ **[7]**

(ii) Show that, when x is large and positive, the solution approximates to a linear function, and state its equation. **[2]**

7 A line l has equation $\mathbf{r} = \begin{pmatrix} -7 \\ -3 \\ 0 \end{pmatrix} + \lambda \begin{pmatrix} 2 \\ -2 \\ 3 \end{pmatrix}$. A plane Π passes through the points (1, 3, 5) and (5, 2, 5), and is parallel to l.

(i) Find an equation of Π, giving your answer in the form $\mathbf{r}.\mathbf{n} = p$. **[4]**

(ii) Find the distance between l and Π. **[4]**

(iii) Find an equation of the line which is the reflection of l in Π, giving your answer in the form $\mathbf{r} = \mathbf{a} + t\mathbf{b}$. **[4]**

8 A set of matrices M is defined by

$$A = \begin{pmatrix} 1 & 0 \\ 0 & 1 \end{pmatrix},\quad B = \begin{pmatrix} \omega & 0 \\ 0 & \omega^2 \end{pmatrix},\quad C = \begin{pmatrix} \omega^2 & 0 \\ 0 & \omega \end{pmatrix},\quad D = \begin{pmatrix} 0 & 1 \\ 1 & 0 \end{pmatrix},\quad E = \begin{pmatrix} 0 & \omega^2 \\ \omega & 0 \end{pmatrix},\quad F = \begin{pmatrix} 0 & \omega \\ \omega^2 & 0 \end{pmatrix},$$

where ω and ω^2 are the complex cube roots of 1. It is given that M is a group under matrix multiplication.

(i) Write down the elements of a subgroup of order 2. **[1]**

(ii) Explain why there is no element X of the group, other than A, which satisfies the equation $X^5 = A$. **[2]**

(iii) By finding BE and EB, verify the closure property for the pair of elements B and E. **[4]**

(iv) Find the inverses of B and E. **[3]**

(v) Determine whether the group M is isomorphic to the group N which is defined as the set of numbers {1, 2, 4, 8, 7, 5} under multiplication modulo 9. Justify your answer clearly. **[3]**

© OCR 2010

Archives & Heritage

OCR
RECOGNISING ACHIEVEMENT

Copyright Information

OCR is committed to seeking permission to reproduce all third-party content that it uses in its assessment materials. OCR has attempted to identify and contact all copyright holders whose work is used in this paper. To avoid the issue of disclosure of answer-related information to candidates, all copyright acknowledgements are reproduced in the OCR Copyright Acknowledgements Booklet. This is produced for each series of examinations, is given to all schools that receive assessment material and is freely available to download from our public website (www.ocr.org.uk) after the live examination series.

If OCR has unwittingly failed to correctly acknowledge or clear any third-party content in this assessment material, OCR will be happy to correct its mistake at the earliest possible opportunity.

For queries or further information please contact the Copyright Team, First Floor, 9 Hills Road, Cambridge CB2 1GE.

OCR is part of the Cambridge Assessment Group; Cambridge Assessment is the brand name of University of Cambridge Local Examinations Syndicate (UCLES), which is itself a department of the University of Cambridge.

© OCR 2010